Name: Key

INTRO to Chapter 4: Graphing angles in radians

Graph each angle below and label it θ.

1. $\theta = \frac{\pi}{4}$

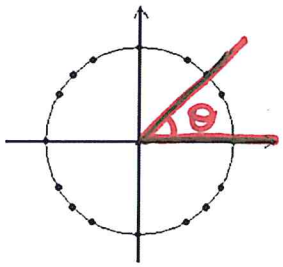

2. $\theta = \frac{3\pi}{2}$

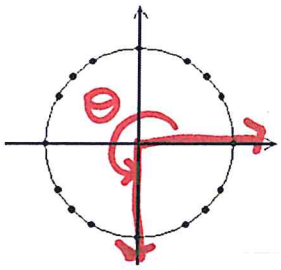

3. $\theta = \pi$

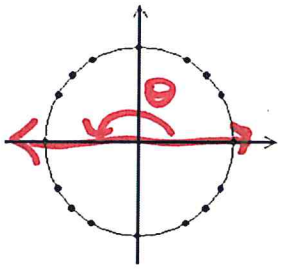

4. $\theta = 2\pi$

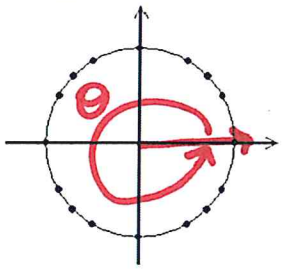

5. $\theta = 3\pi$

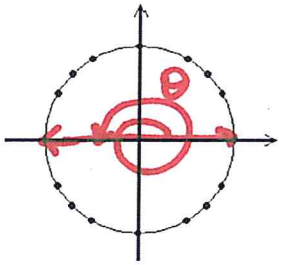

6. $\theta = 4\pi$

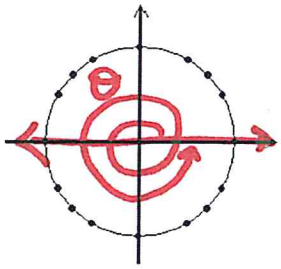

7. $\theta = \frac{\pi}{6}$

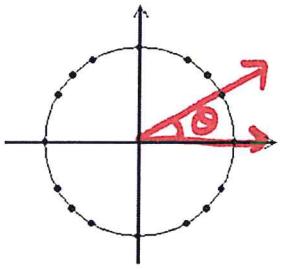

8. $\theta = \frac{\pi}{3}$

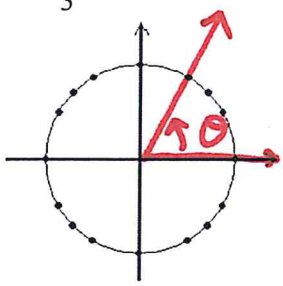

9. $\theta = \frac{\pi}{2}$

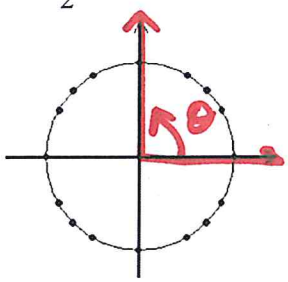

10. $\theta = 17\pi$

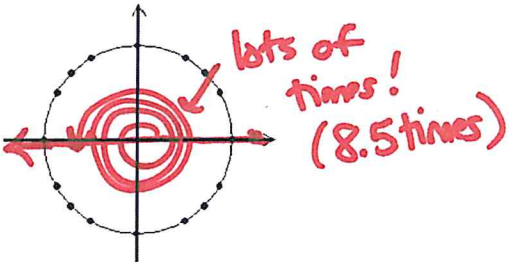

11. $\theta = \frac{5\pi}{6}$

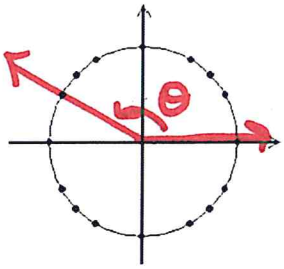

12. $\theta = \frac{11\pi}{6}$

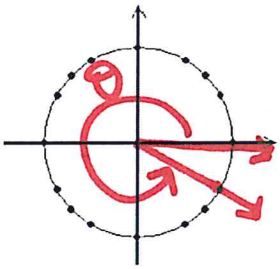

13. $\theta = \frac{5\pi}{4}$

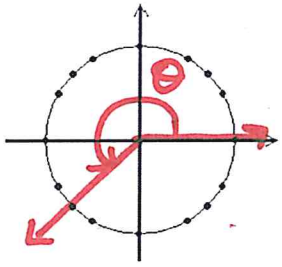

14. $\theta = \frac{7\pi}{3}$

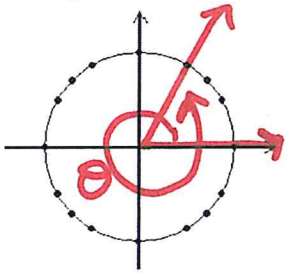

15. $\theta = \frac{4\pi}{3}$

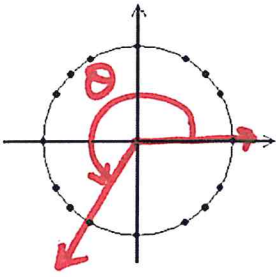
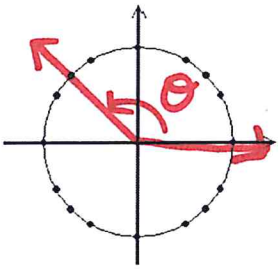
16. $\theta = \frac{3\pi}{4}$